Name_____

Exact Trig Values of Special Angles

Date_____ Period____

Find the exact value of each trigonometric function.

1) tan θ

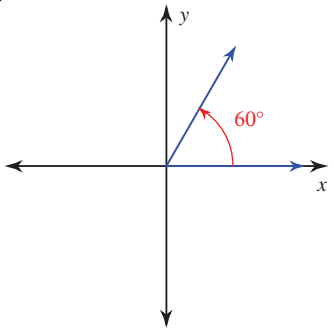

2) sin θ

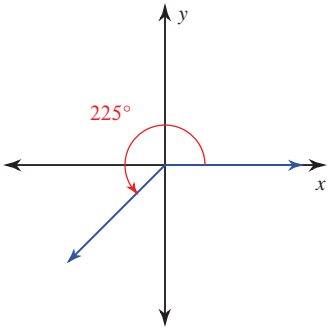

3) sin θ

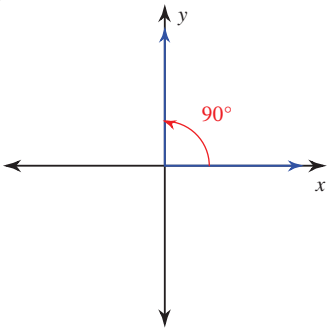

4) cos θ

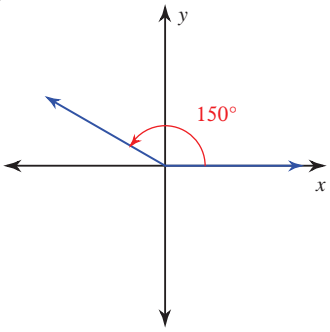

5) cos θ

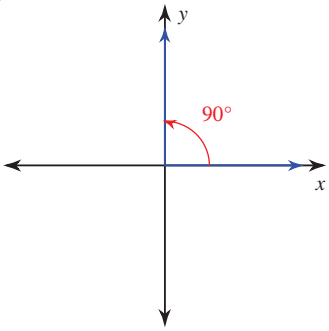

6) tan θ

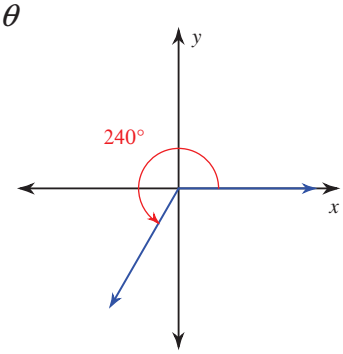

7) cos θ

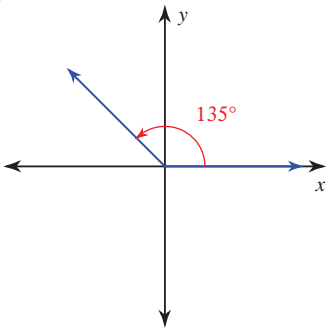

8) tan θ

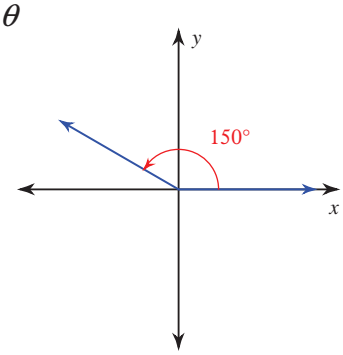

9) $\cos\theta$

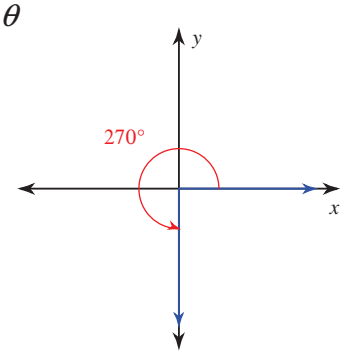

10) $\tan\theta$

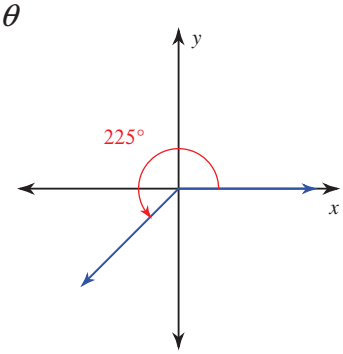

11) $\cos 270°$

12) $\sin 0$

13) $\cot \frac{7\pi}{4}$

14) $\csc \frac{2\pi}{3}$

15) $\csc 225°$

16) $\sin 300°$

17) $\csc 90°$

18) $\tan 240°$

19) $\sin \frac{\pi}{4}$

20) $\tan 120°$

21) $\tan -\frac{13\pi}{6}$

22) $\cos -630°$

23) $\cos 990°$

24) $\csc -\frac{31\pi}{6}$

25) $\csc -\frac{5\pi}{6}$

26) $\cos -\frac{17\pi}{3}$

27) $\sin \frac{29\pi}{6}$

28) $\sec 945°$

29) $\cos -\frac{11\pi}{2}$

30) $\sin -2\pi$